Complete the following reactions. Circle the most favored products.

1. 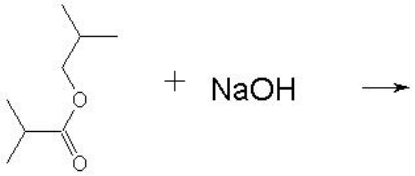

2. 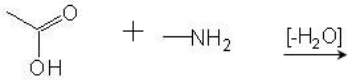

3. 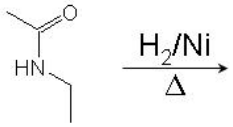

4. 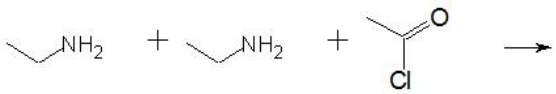

5. 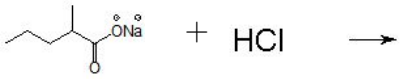

6. 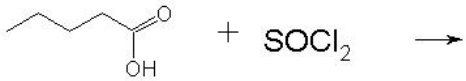

7. 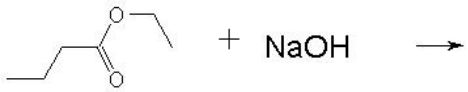

8. 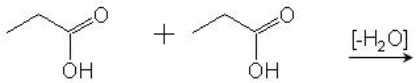

9. 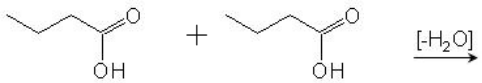

10. 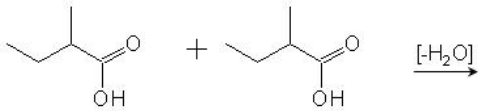

11. 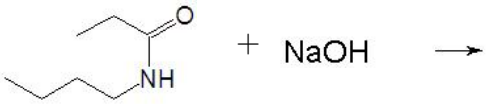

12. 

13. 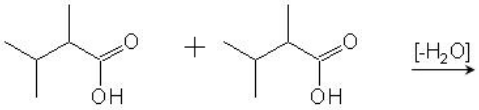

14. 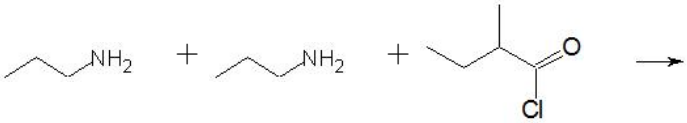

15. 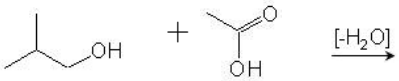

16. 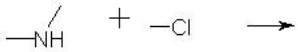

17. 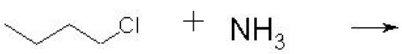

18. 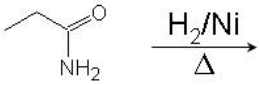

19.

20. 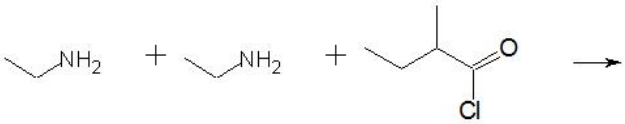

Question 1: 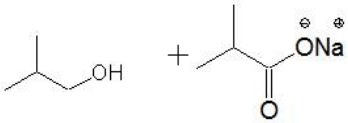

Question 2:

+ H_2O

Question 3: 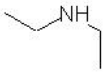

+ H_2O

Question 4: 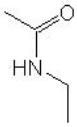

+ 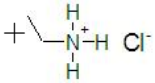

Question 5: 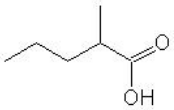

+ NaCl

Question 6: 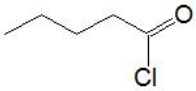

+ HCl + SO_2

Question 7:

+ 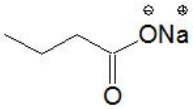

Question 8: 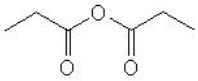

+ H_2O

Question 9: 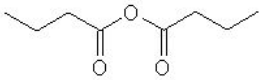

+ H_2O

Question 10: 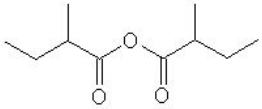

+ H_2O

Question 11: 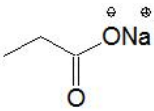

+

Question 12: 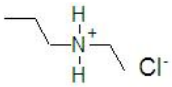

Question 13: 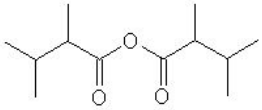

+ H_2O

Question 14: 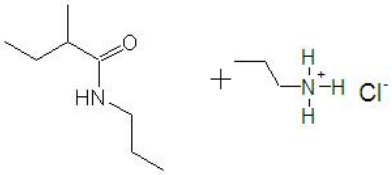

Question 15: 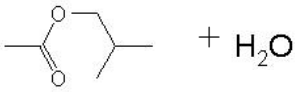

Question 16:

Question 17: 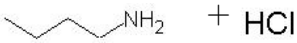

Question 18: 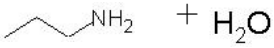

Question 19: 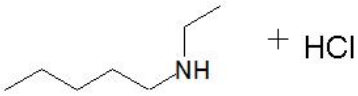
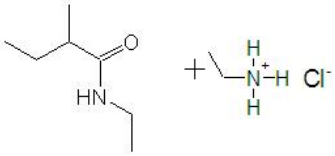
Question 20: