Complete the following reactions. Circle the most favored products.

1. 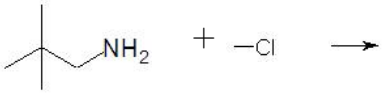

2. 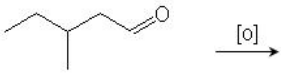

3. 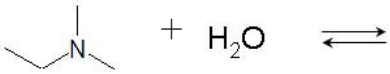

4. 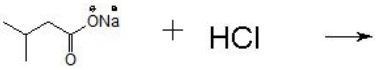

5. 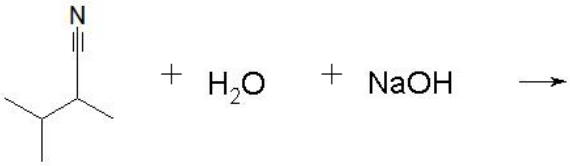

6. 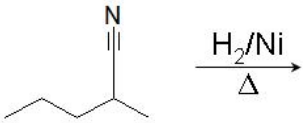

7. 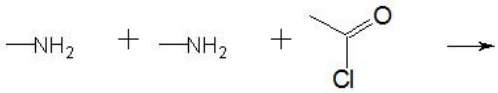

8. 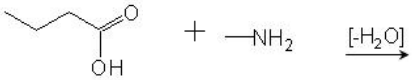

9. 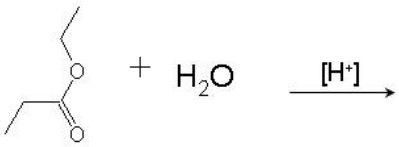

10. 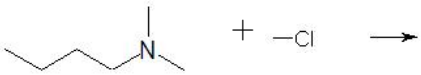

11. 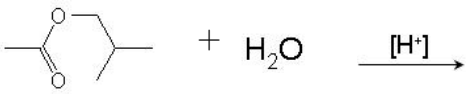

12. 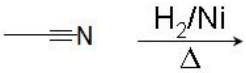

13.

14. 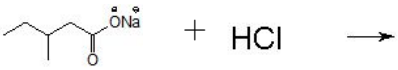

15. 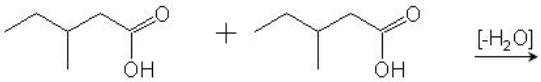

16. 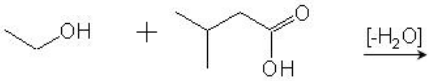

17.

18. 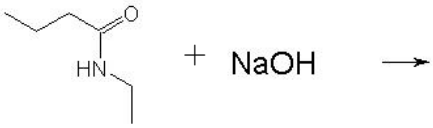

19. 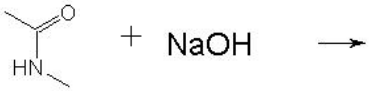

20. 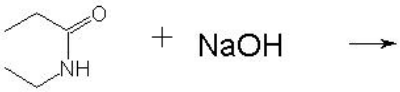

Question 1: 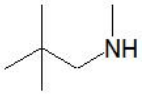

+ HCl

Question 2: 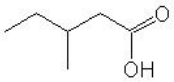

Question 3:

+ OH^-

Question 4: 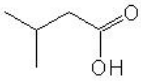

+ NaCl

Question 5: 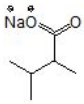

+$NH_{3(aq)}$

Question 6: 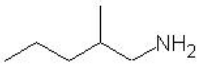

Question 7:

+

Cl^-

Question 8: 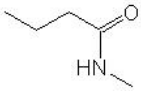

+ H_2O

Question 9:

+ 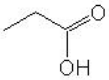

Question 10: 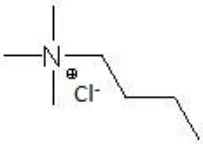

Question 11: 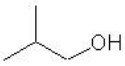

+

Question 12:

Question 13:

+ OH^-

Question 14: 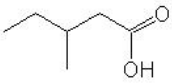

+ NaCl

Question 15: 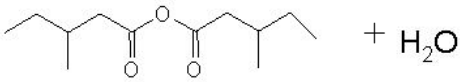

Question 16: 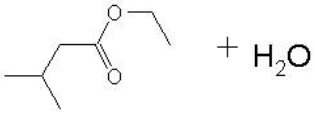

Question 17: 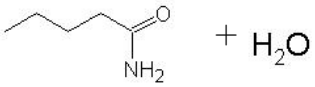

Question 18: 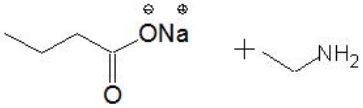

Question 19: 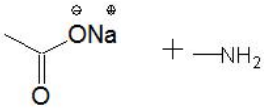
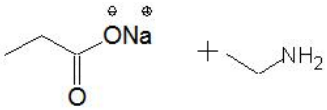
Question 20: