Complete the following reactions. Circle the most favored products.

1. 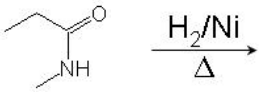

2.

3. 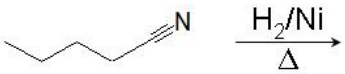

4.

5. 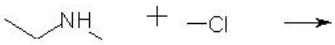

6. 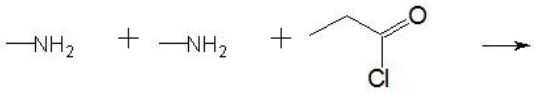

7.

8. 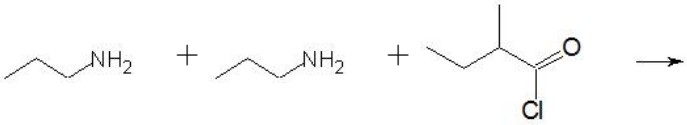

9.

10.

11. 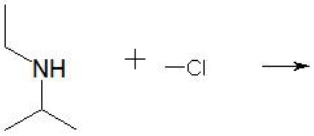

12. 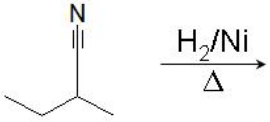

13. 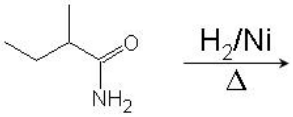

14.

15. 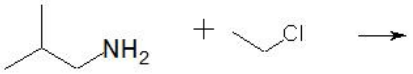

16. 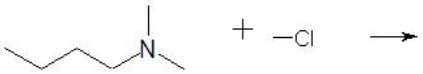

17. 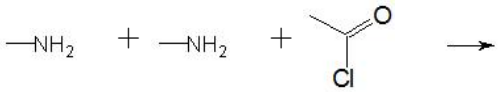

18. 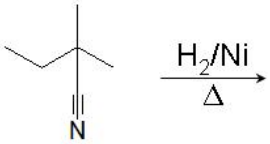

19. 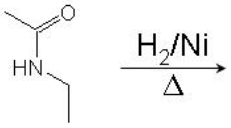

20. 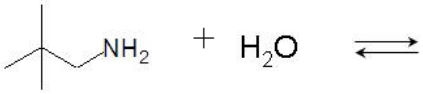

21. 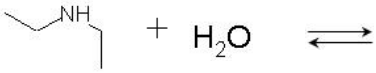

22. 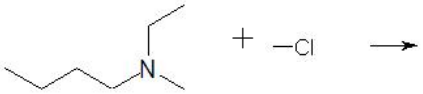

23. 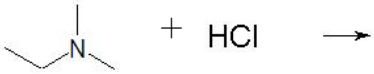

Question 1: 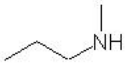 + H_2O

Question 2: 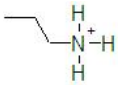 Cl^-

Question 3:

Question 4: 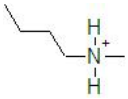 + OH^-

Question 5: 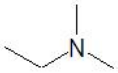 + HCl

Question 6: 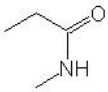 + 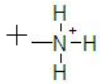 Cl^-

Question 7: 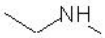 + HCl

Question 8: 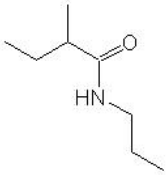 + 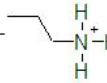 Cl^-

Question 9: 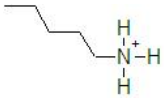 Cl^-

Question 10: 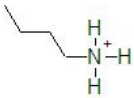 + OH^-

Question 11: 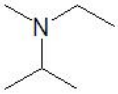 + HCl

Question 12: 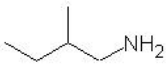

Question 13: 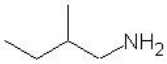 + H_2O

Question 14: 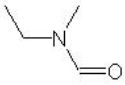 + H_2O

Question 15: 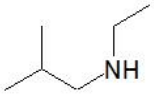 + HCl

Question 16: 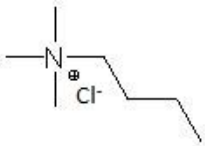

Question 17: 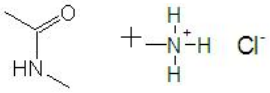

Question 18: 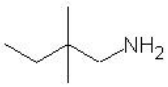

Question 19: 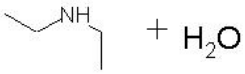

Question 20: 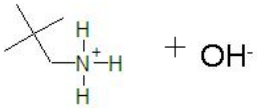

Question 21: 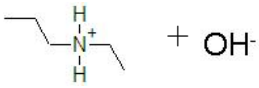

Question 22: 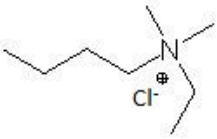
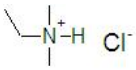
Question 23: