Complete the following reactions. Circle the most favored products.

1.

2. 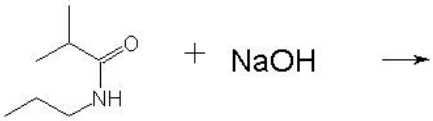

3. 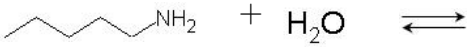

4. 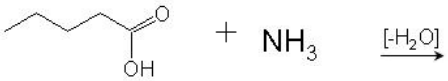

5. 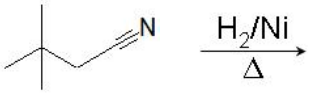

6. 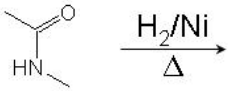

7. 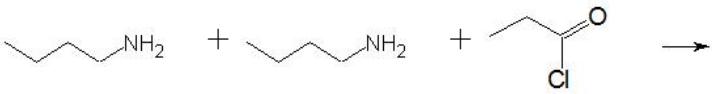

8. 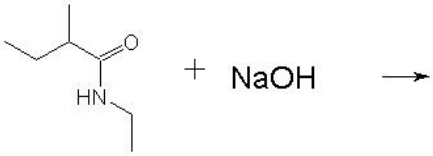

9. 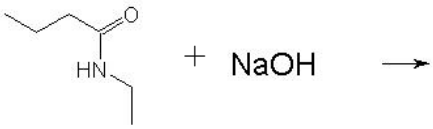

10.

11. 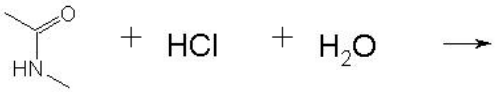

12. 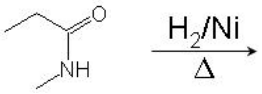

13. 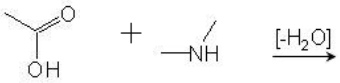

14. 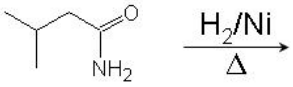

15. 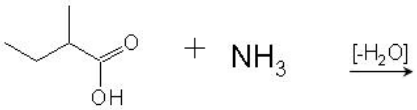

16. 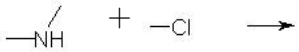

17. 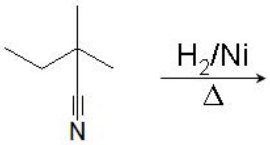

18. 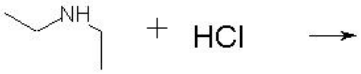

19. 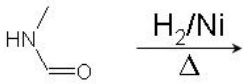

20. 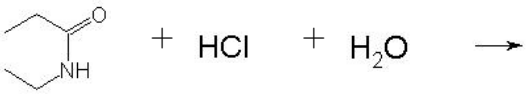

Question 1: 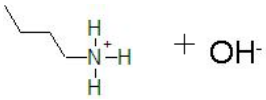

Question 2: 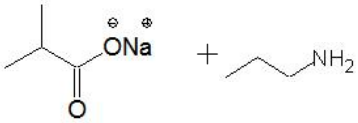

Question 3: 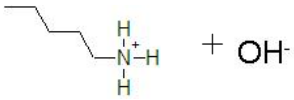

Question 4: 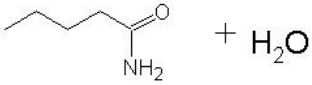

Question 5: 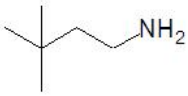

Question 6:

Question 7: 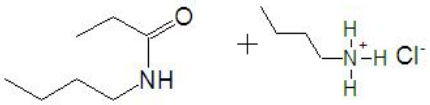

Question 8: 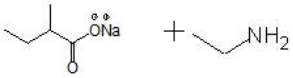

Question 9: 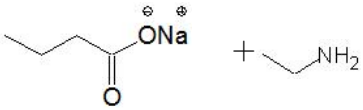

Question 10: 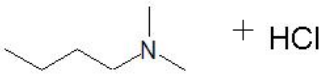

Question 11: 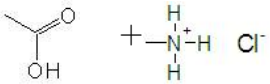

Question 12: 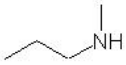

Question 13:

Question 14: 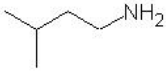

Question 15: 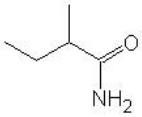

+ H_2O

Question 16:

+ HCl

Question 17: 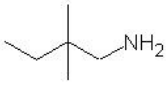

Question 18: 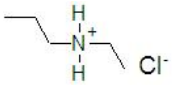

Question 19:

+ H_2O

Question 20: 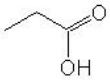
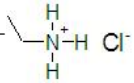
+