Complete the following reactions. Circle the most favored products.

1. 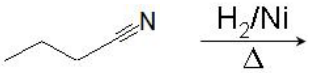

2. 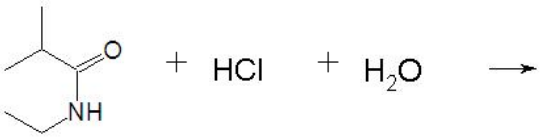

3. 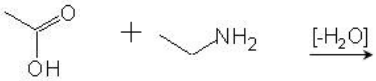

4. 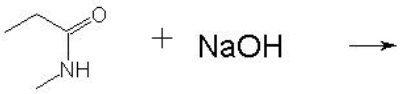

5. 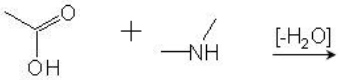

6.

7. 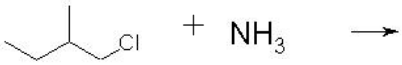

8. 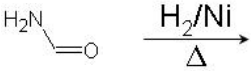

9. 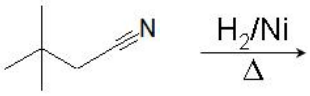

10. 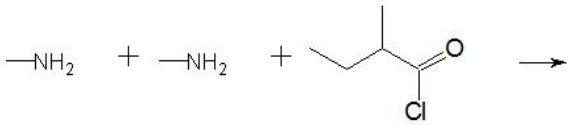

11.

12. 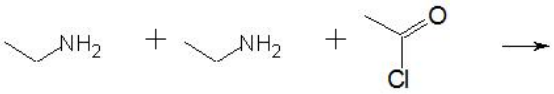

13. 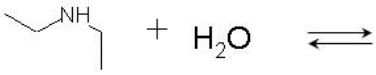

14.

15. 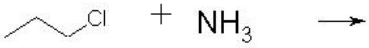

16. 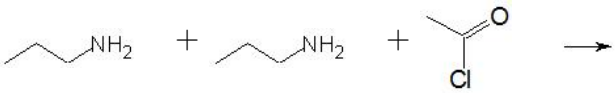

17. 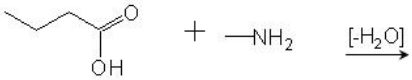

18. 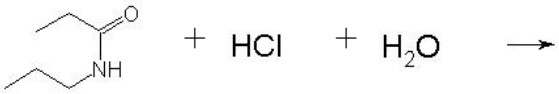

19. 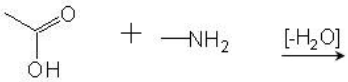

20. 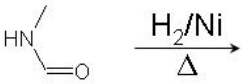

Question 1:

Question 2: 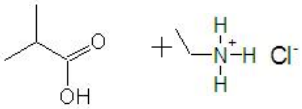

Question 3: 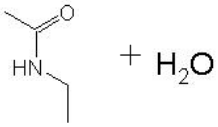

Question 4: 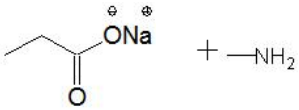

Question 5: 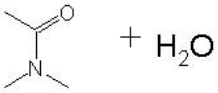

Question 6: 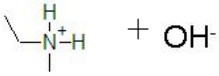

Question 7: 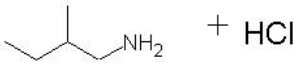

Question 8: 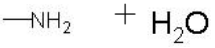

Question 9: 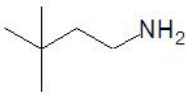

Question 10: 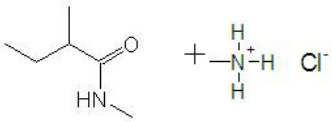

Question 11:

Question 12: 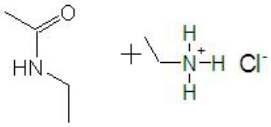

Question 13: 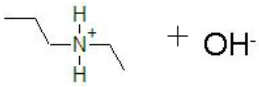

Question 14: 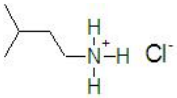

Question 15: 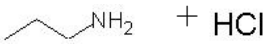

Question 16: 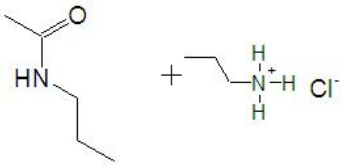

Question 17: 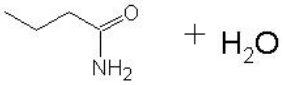

Question 18: 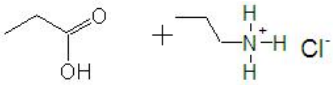

Question 19: 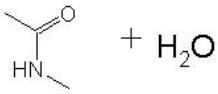
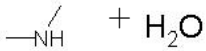
Question 20: