Complete the following reactions. Circle the most favored products.

1. 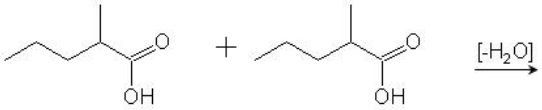

2. 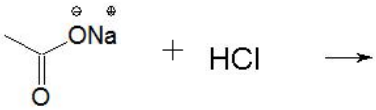

3. 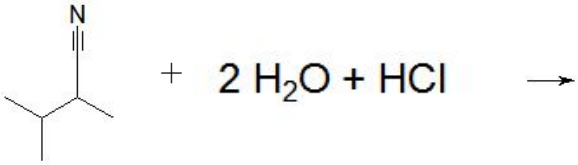

4. 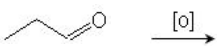

5.

6. 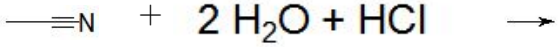

7. 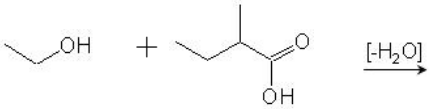

8. 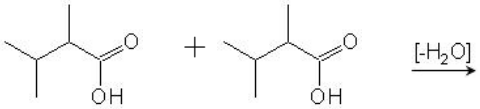

9. 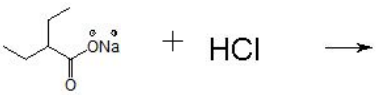

10. 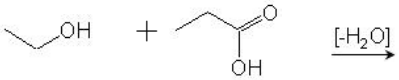

11. 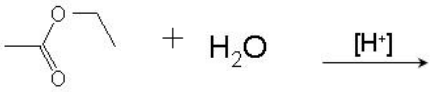

12. 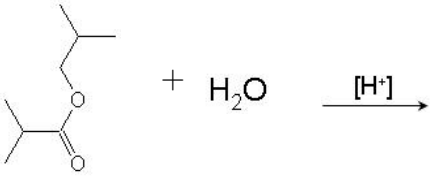

13. 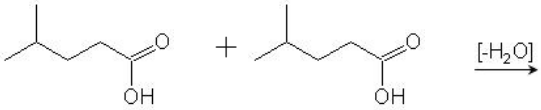

14. 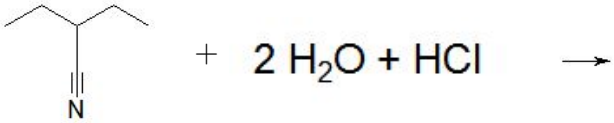

15. 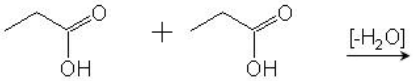

16. 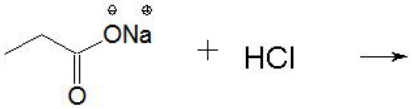

17. 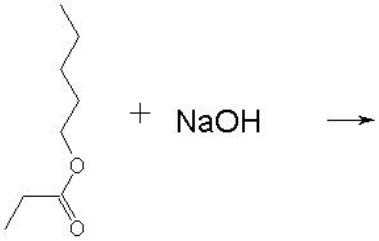

18. 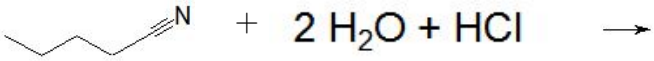

19. 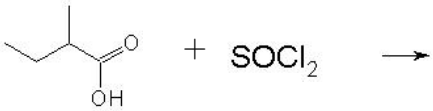

20. 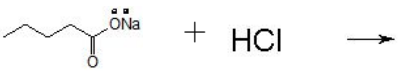

Question 1: 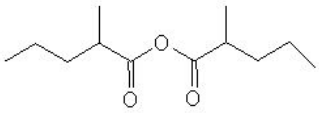 + H_2O

Question 2: + NaCl

Question 3: 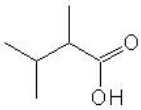 + $\overset{+}{N}H_4Cl^-$

Question 4: 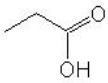

Question 5: 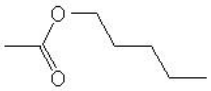 + H_2O

Question 6: + $\overset{+}{N}H_4Cl^-$

Question 7: 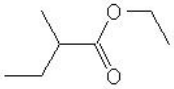 + H_2O

Question 8: 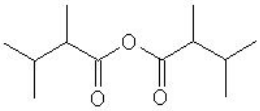 + H_2O

Question 9: 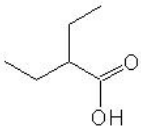 + NaCl

Question 10: 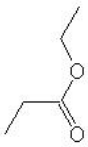 + H_2O

Question 11: +

Question 12: 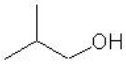 + 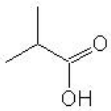

Question 13: 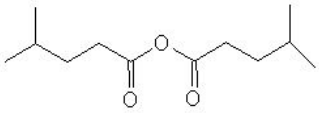 + H_2O

Question 14: 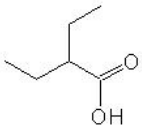 + $\overset{+}{N}H_4Cl^-$

Question 15: 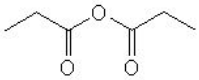 + H_2O

Question 16: 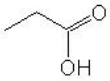 + NaCl

Question 17: + 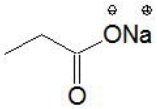

Question 18: 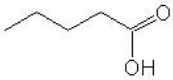 + $\overset{+}{N}H_4Cl^-$

Question 19: 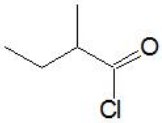 + HCl + SO_2

Question 20: 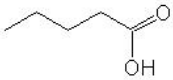 + NaCl